eduresourceza.com

Downloaded from eduresourceza.com

Cambridge Assessment International Education

Cambridge IGCSE™

CANDIDATE NAME	

CENTRE NUMBER						CANDIDATE NUMBER				

6388046 30

CHEMISTRY **0620/43**

Paper 4 Theory (Extended) **October/November 2021**

1 hour 15 minutes

You must answer on the question paper.

No additional materials are needed.

INSTRUCTIONS

- Answer **all** questions.
- Use a black or dark blue pen. You may use an HB pencil for any diagrams or graphs.
- Write your name, centre number and candidate number in the boxes at the top of the page.
- Write your answer to each question in the space provided.
- Do **not** use an erasable pen or correction fluid.
- Do **not** write on any bar codes.
- You may use a calculator.
- You should show all your working and use appropriate units.

INFORMATION

- The total mark for this paper is 80.
- The number of marks for each question or part question is shown in brackets [ ].
- The Periodic Table is printed in the question paper.

This document has **16** pages. Any blank pages are indicated.

IB21 11_0620_43/3RP
© UCLES 2021

Downloaded from eduresourceza.com

Downloaded from eduresourceza.com

1 A list of substances is shown.

ammonia
bauxite
carbon dioxide
carbon monoxide
ethanol
hematite
oxygen
sodium chloride
sulfur dioxide

Answer the questions using the list of substances.

Each substance may be used once, more than once or not at all.

State which substance is:

(a) an element ..... [1]

(b) an ore of aluminium ..... [1]

(c) a gas that causes acid rain ..... [1]

(d) used as a fuel ..... [1]

(e) an ionic compound ..... [1]

(f) produced in the Haber process ..... [1]

(g) a product of respiration ..... [1]

(h) a toxic product of the incomplete combustion of hydrocarbons

..... [1]

(i) a gas produced in the test for nitrate ions. ..... [1]

[Total: 9]

Downloaded from eduresourceza.com

Downloaded from eduresourceza.com

2 This question is about electrolysis.

(a) State the meaning of the term *electrolyte*.

.....

..... [2]

(b) The table gives information about the electrolysis of two electrolytes. Carbon (graphite) electrodes are used in each experiment.

(i) Complete the table to show the observations and products of electrolysis.

	positive electrode (anode)		negative electrode (cathode)	
electrolyte	observations	name of product	observations	name of product
aqueous copper(II) sulfate	colourless bubbles			
concentrated aqueous sodium bromide			colourless bubbles	hydrogen

[5]

(ii) Hydrogen is produced at the negative electrode (cathode) during the electrolysis of concentrated aqueous sodium bromide.

Write the ionic half-equation for this reaction.

..... [2]

(iii) State **two** reasons why carbon (graphite) is suitable to use as an electrode.

1 .....

2 .....
[2]

(iv) Name the particle responsible for the conduction of electricity in the metal wires used in a circuit.

..... [1]

[Total: 12]

Downloaded from eduresourceza.com

Downloaded from eduresourceza.com

3 Lead is a metallic element in Group IV. One of the ores of lead is galena, which is an impure form of lead(II) sulfide, PbS.

Lead also occurs in the ore cerussite, which contains lead(II) carbonate, $PbCO_3$.

(a) Calculate the relative formula mass, M_r, of $PbCO_3$.

M_r of $PbCO_3$ = ... [1]

(b) The M_r of PbS is 239.

Calculate the percentage of lead by mass in PbS.

percentage of lead by mass in PbS = ... [1]

(c) The percentage of lead by mass in $PbCO_3$ is 77.5%.

Use this information and your answer to **(b)** to suggest whether it would be better to extract lead from $PbCO_3$ or PbS.

Give a reason for your answer.

.....

..... [1]

(d) When lead(II) carbonate is heated it decomposes into lead(II) oxide, PbO, and carbon dioxide.

Write a chemical equation for this reaction.

..... [1]

(e) Lead(II) carbonate reacts with dilute nitric acid. One of the products is aqueous lead(II) nitrate, $Pb(NO_3)_2$.

Write a chemical equation for this reaction.

..... [2]

Downloaded from eduresourceza.com

Downloaded from eduresourceza.com

(f) Lead(II) oxide and carbon dioxide are oxides of Group IV elements.

(i) Complete the diagram to show the electron arrangement in one molecule of CO_2. Show only the outer electrons.

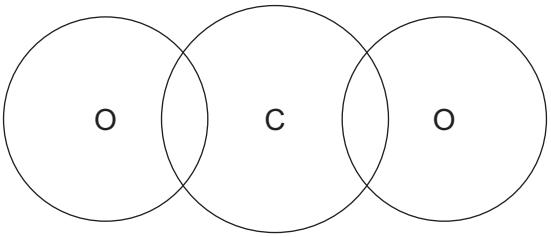

[2]

(ii) The melting points of lead(II) oxide and carbon dioxide are shown.

	melting point / °C
lead(II) oxide	886
carbon dioxide	–56

Use your knowledge of structure and bonding to explain why lead(II) oxide has a much higher melting point than carbon dioxide.

Your answer should refer to:

- the types of particles involved
- the relative strength of the forces of attraction between the particles.

.....

.....

.....

..... [3]

Downloaded from eduresourceza.com

Downloaded from eduresourceza.com

(g) Part of the reactivity series is shown.

magnesium	most reactive
lead	↑
copper	least reactive

Aqueous lead(II) nitrate contains Pb^{2+} ions.

Two experiments are carried out.

In Experiment 1, magnesium is added to aqueous lead(II) nitrate.

In Experiment 2, copper is added to aqueous lead(II) nitrate.

Write an ionic equation for any reaction that occurs in each experiment. If no reaction occurs write 'no reaction'.

Experiment 1 .....

Experiment 2 .....
[2]

(h) When lead(II) nitrate is heated it decomposes to produce the same gaseous products as when copper(II) nitrate is heated.

(i) One of the gaseous products is oxygen.

Describe a test for oxygen.

test .....

observations .....
[2]

(ii) Name the other gaseous product.

..... [1]

[Total: 16]

Downloaded from eduresourceza.com
© UCLES 2021

Downloaded from eduresourceza.com

4 Carbon is an important element.

(a) Carbon exists as the isotopes $^{12}_{6}C$ and $^{13}_{6}C$.

Complete the table.

isotope	number of protons in one atom	number of electrons in one atom	number of neutrons in one atom
$^{12}_{6}C$			
$^{13}_{6}C$			

[2]

(b) Name **two** forms of the element carbon which have giant covalent structures.

..... and ..... [1]

(c) The Avogadro constant is the number of particles in 1 mole.

The numerical value of the Avogadro constant is 6.02×10^{23}.

(i) Calculate the number of molecules in 22.0 g of carbon dioxide, CO_2.

..... molecules [2]

(ii) Calculate the number of molecules in 6.00 dm^3 of carbon dioxide gas at room temperature and pressure.

..... molecules [1]

[Total: 6]

Downloaded from eduresourceza.com

Downloaded from eduresourceza.com

5 **(a)** Dilute sulfuric acid and aqueous sodium hydroxide can be used to prepare sodium sulfate crystals using a method that involves titration.

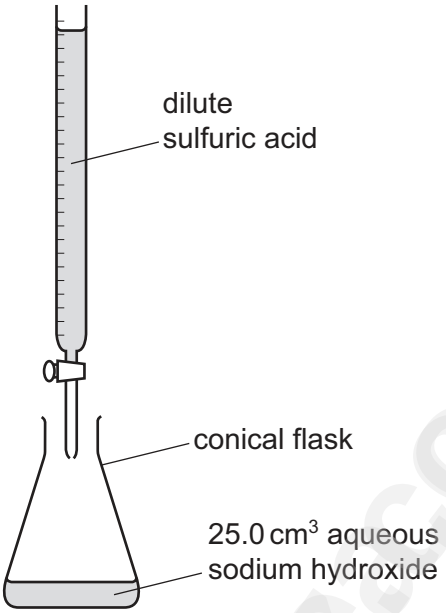

(i) Suggest why universal indicator is **not** suitable for this titration.

..... [1]

(ii) Name an indicator that can be used in this titration.

..... [1]

20.0 cm^3 of dilute sulfuric acid neutralises 25.0 cm^3 of 1.00 mol / dm^3 aqueous sodium hydroxide. At the end of the titration the conical flask contains aqueous sodium sulfate with the dissolved indicator as an impurity.

(b) Describe how to prepare a **pure** sample of sodium sulfate crystals from the original solutions of dilute sulfuric acid and aqueous sodium hydroxide of the same concentrations.

You are not required to give details of how to carry out the titration.

.....

.....

.....

.....

.....

.....

.....

.....

..... [5]

Downloaded from eduresourceza.com

Downloaded from eduresourceza.com

(c) Sodium hydrogensulfate, $NaHSO_4$, dissolves in water to produce an aqueous solution, **X**, containing Na^+, H^+ and SO_4^{2-} ions.

State the observations when the following tests are done.

(i) A flame test is carried out on **X**.

..... [1]

(ii) Copper(II) oxide is warmed with an excess of **X**.

.....

..... [2]

(iii) Acidified aqueous barium nitrate is added to **X**.

..... [1]

[Total: 11]

Downloaded from eduresourceza.com

Downloaded from eduresourceza.com

6 A student investigates the decomposition of hydrogen peroxide in the presence of a catalyst of manganese(IV) oxide.

$$2H_2O_2(aq) \rightarrow 2H_2O(l) + O_2(g)$$

(a) State the meaning of the term *catalyst*.

.....

..... [2]

(b) The diagram shows the equipment the student uses.

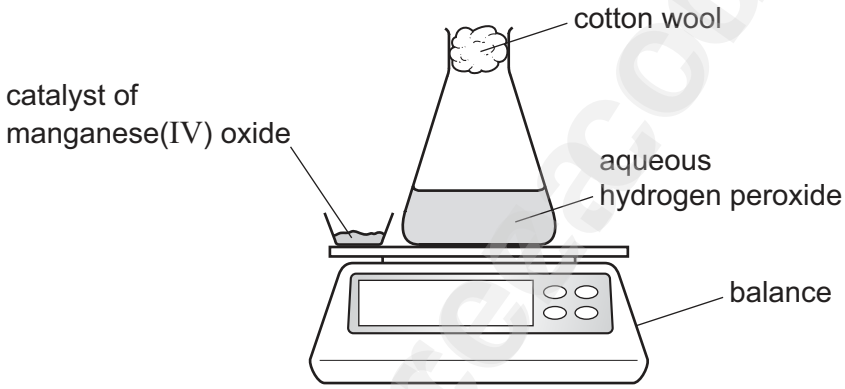

The student uses this method:

- the catalyst is added to the aqueous hydrogen peroxide
- the stop-clock is started
- the mass of the flask and contents is recorded at regular time intervals.

Downloaded from eduresourceza.com
© UCLES 2021

Downloaded from eduresourceza.com

A graph of the mass of the flask and contents against time is shown.

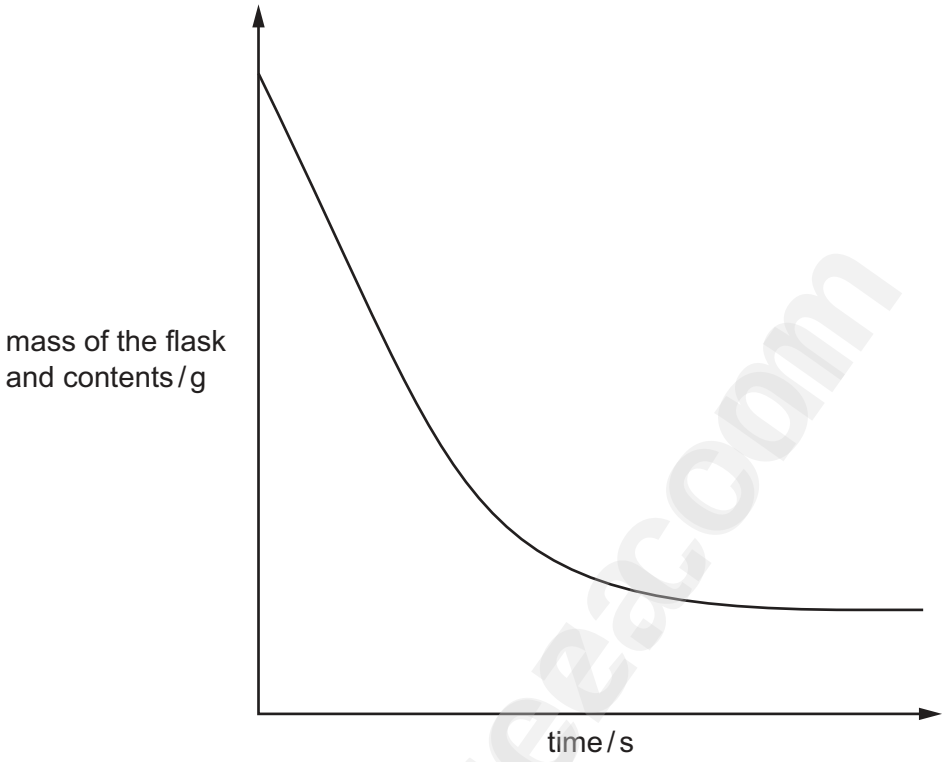

(i) Suggest why the mass of the flask and contents decreases as time increases.

..... [1]

(ii) Describe what happens to the rate of the reaction as time increases.

.....

..... [2]

(c) The student repeats the experiment at a higher temperature. All other conditions stay the same. The rate of reaction increases.

(i) Explain, in terms of collisions between particles, why the rate of reaction increases at a higher temperature.

.....

.....

.....

..... [3]

(ii) Draw a line on the graph in **(b)** for the experiment at a higher temperature. [2]

[Total: 10]

Downloaded from eduresourceza.com

Downloaded from eduresourceza.com

7 **(a)** Ethanol is a member of the homologous series of alcohols.

Give **two** characteristics of members of a homologous series.

1 .....

2 .....
[2]

(b) Ethanol can be manufactured from ethene.

Ethene can be made from long chain hydrocarbons such as decane, $C_{10}H_{22}$.

Ethene is then converted into ethanol.

(i) Name the process used to obtain ethene from long chain hydrocarbons such as decane, $C_{10}H_{22}$.

..... [1]

(ii) Complete the chemical equation to show the formation of ethene from decane, $C_{10}H_{22}$.

$$C_{10}H_{22} \rightarrow C_4H_8 + \text{.....} + \text{.....}$$ [2]

(iii) Write the chemical equation for the conversion of ethene into ethanol.

..... [1]

(iv) Name the type of reaction occurring when ethene is converted into ethanol.

..... [1]

(v) Give **one** condition for the reaction in which ethene is converted into ethanol.

..... [1]

(c) Ethanol can also be produced by fermentation of carbohydrates such as glucose.

Give **two** advantages of manufacturing ethanol by fermentation compared to manufacturing ethanol from ethene.

1 .....

2 .....
[2]

Downloaded from eduresourceza.com

Downloaded from eduresourceza.com

(d) **(i)** Under certain conditions ethene can react with chlorine to produce chloroethene.

The structure of chloroethene is shown.

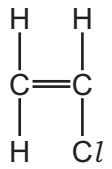

The equation for the chemical reaction is shown.

$$C_2H_4 + Cl_2 \rightarrow C_2H_3Cl + HCl$$

State the type of chemical reaction between ethene and chlorine that this equation shows.

..... [1]

(ii) Chloroethene monomers can be converted into a polymer called poly(chloroethene).

State the type of polymerisation that produces poly(chloroethene) from chloroethene.

..... [1]

(iii) Draw a section of the poly(chloroethene) molecule made from **two** monomer molecules.

[2]

Downloaded from eduresourceza.com

Downloaded from eduresourceza.com

(e) The structure of part of a polymer is shown.

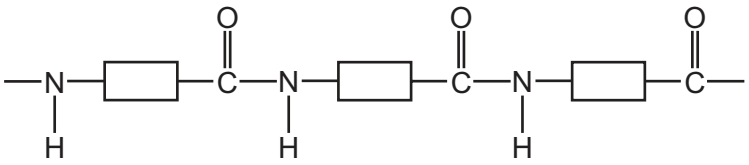

This polymer is made from one type of monomer only.

Complete the diagram to show the structure of the monomer used to produce this polymer.
Show all of the atoms and all of the bonds in the functional groups.



[2]

[Total: 16]

Downloaded from eduresourceza.com

Downloaded from eduresourceza.com

BLANK PAGE

Permission to reproduce items where third-party owned material protected by copyright is included has been sought and cleared where possible. Every reasonable effort has been made by the publisher (UCLES) to trace copyright holders, but if any items requiring clearance have unwittingly been included, the publisher will be pleased to make amends at the earliest possible opportunity.

To avoid the issue of disclosure of answer-related information to candidates, all copyright acknowledgements are reproduced online in the Cambridge Assessment International Education Copyright Acknowledgements Booklet. This is produced for each series of examinations and is freely available to download at www.cambridgeinternational.org after the live examination series.

Cambridge Assessment International Education is part of the Cambridge Assessment Group. Cambridge Assessment is the brand name of the University of Cambridge Local Examinations Syndicate (UCLES), which itself is a department of the University of Cambridge.

Downloaded from eduresourceza.com

Downloaded from edureesourceza.com

The Periodic Table of Elements

Key

atomic number
atomic symbol
name
relative atomic mass

Group																	
I	II											III	IV	V	VI	VII	VIII
							1 **H** hydrogen 1										2 **He** helium 4
3 **Li** lithium 7	4 **Be** beryllium 9											5 **B** boron 11	6 **C** carbon 12	7 **N** nitrogen 14	8 **O** oxygen 16	9 **F** fluorine 19	10 **Ne** neon 20
11 **Na** sodium 23	12 **Mg** magnesium 24											13 **Al** aluminium 27	14 **Si** silicon 28	15 **P** phosphorus 31	16 **S** sulfur 32	17 **Cl** chlorine 35.5	18 **Ar** argon 40
19 **K** potassium 39	20 **Ca** calcium 40	21 **Sc** scandium 45	22 **Ti** titanium 48	23 **V** vanadium 51	24 **Cr** chromium 52	25 **Mn** manganese 55	26 **Fe** iron 56	27 **Co** cobalt 59	28 **Ni** nickel 59	29 **Cu** copper 64	30 **Zn** zinc 65	31 **Ga** gallium 70	32 **Ge** germanium 73	33 **As** arsenic 75	34 **Se** selenium 79	35 **Br** bromine 80	36 **Kr** krypton 84
37 **Rb** rubidium 85	38 **Sr** strontium 88	39 **Y** yttrium 89	40 **Zr** zirconium 91	41 **Nb** niobium 93	42 **Mo** molybdenum 96	43 **Tc** technetium –	44 **Ru** ruthenium 101	45 **Rh** rhodium 103	46 **Pd** palladium 106	47 **Ag** silver 108	48 **Cd** cadmium 112	49 **In** indium 115	50 **Sn** tin 119	51 **Sb** antimony 122	52 **Te** tellurium 128	53 **I** iodine 127	54 **Xe** xenon 131
55 **Cs** caesium 133	56 **Ba** barium 137	57–71 lanthanoids	72 **Hf** hafnium 178	73 **Ta** tantalum 181	74 **W** tungsten 184	75 **Re** rhenium 186	76 **Os** osmium 190	77 **Ir** iridium 192	78 **Pt** platinum 195	79 **Au** gold 197	80 **Hg** mercury 201	81 **Tl** thallium 204	82 **Pb** lead 207	83 **Bi** bismuth 209	84 **Po** polonium –	85 **At** astatine –	86 **Rn** radon –
87 **Fr** francium –	88 **Ra** radium –	89–103 actinoids	104 **Rf** rutherfordium –	105 **Db** dubnium –	106 **Sg** seaborgium –	107 **Bh** bohrium –	108 **Hs** hassium –	109 **Mt** meitnerium –	110 **Ds** darmstadtium –	111 **Rg** roentgenium –	112 **Cn** copernicium –		114 **Fl** flerovium –		116 **Lv** livermorium –		

lanthanoids	57 **La** lanthanum 139	58 **Ce** cerium 140	59 **Pr** praseodymium 141	60 **Nd** neodymium 144	61 **Pm** promethium –	62 **Sm** samarium 150	63 **Eu** europium 152	64 **Gd** gadolinium 157	65 **Tb** terbium 159	66 **Dy** dysprosium 163	67 **Ho** holmium 165	68 **Er** erbium 167	69 **Tm** thulium 169	70 **Yb** ytterbium 173	71 **Lu** lutetium 175
actinoids	89 **Ac** actinium –	90 **Th** thorium 232	91 **Pa** protactinium 231	92 **U** uranium 238	93 **Np** neptunium –	94 **Pu** plutonium –	95 **Am** americium –	96 **Cm** curium –	97 **Bk** berkelium –	98 **Cf** californium –	99 **Es** einsteinium –	100 **Fm** fermium –	101 **Md** mendelevium –	102 **No** nobelium –	103 **Lr** lawrencium –

The volume of one mole of any gas is 24 dm^3 at room temperature and pressure (r.t.p.).

© UCLES 2021

Downloaded from edureesourceza.com